kenyaeducators@gmail.com

HIGH STRATEGIES

CLASS 5

SERIES 3

FOR MARKING SCHEMES CALL O795491185

FOR MORE E-RESOURCES CALL: 0795491185

HIGH STRATEGIES EXAM SERIES

TISMAR CODE 03

STD. 5 - END OF TERM 1 - YEAR 2020

5

ENGLISH: LANGUAGE

Time: 1hrs 40 min

Read the following passage. It has blank spaces numbered 1 to 15. Complete the passage by filling the blanks correctly.

___1___ostrich is a very___2___bird. It is___3___largest bird___4___the world. It can ___5___to a height of 2.7 metres. Although it___6___wings, it___7___not fly. It uses ___8___ wings to balance itself as it___9___. Its eggs weigh about 2 kilograms each. This is about ___10___times the weight of a___11___egg.

When an ostrich___12___danger, it lies down and___13___its neck flat on the ground. From this position, it is ___14___to look around without being seen. When really frightened, it gets up and runs very fast. It can run faster than the___15___horse.

1.	A.A	B. The	C. Because	D. It
2.	A. interesting	B. interest	C. interested	D. interester
3.	A. for	B. in	C. at	D. the
4.	A. no	B. in	C. at	D. for
5.	A. grew	B. grow	C. grewed	D. grown
6.	A. is	B. have	C. has	D. have
7.	A. doing	B. did	C. does	D. do
8.	A. it's	B. its	C. it	D. its'
9.	A. ran	B. runned	C. ranned	D. runs
10.	A. forty fife	B. fourty five	C. forty five	D. foty five
11.	A. hen's	B. hens'	C. hen	D. henned
12.	A. saw	B. sees	C. sawing	D. sawed
13.	A. strech	B. stretch	C. streches	D. stretches
14.	A. apple	B. able	C. ability	D. enable
15.	A. fast	B. faster	C. fastest	D. most forstest

Use the correct word to complete the sentences below.

16. The chimney is covered with_____.

A. shoot B. soot

C. shut D. suit

17. If you want to take a holiday, you have to_____ some money.

A. shave B. save

C. share D. eat

18. The mother of her husband is her_____

A. father-in-law B. daughter -in-law

C. mother - in - law D. son-in-law

Choose the correct preposition for the blanks.

19. My friend is always absent_____school.

A. in B. at

C. for D. from

20. The ball went _____the window into the room.

A. in B. through

C. at D. on

21. Mulinge is good _____Mathematics.

A. for B. at

C. in D. on

22. Peter prefers sausages_____rice.

A. to B. than

C. more D. for

Choose the plural of the underlined words.

23. Many people visit our <u>city</u> everyday.

A. city B. citys

C. cityses D. cities

24. The hungry traveller ate a <u>berry</u>.

A. berrys B. berries

C. beries D. berryses

25. One injured motorist had a <u>scratch</u> on the face.

A. scratches B. scratch

C. scratched D. scrutches

Choose the correct word for the blanks in questions 26 and 27.

26. Our journey took a_____day.

A. hawl B. hole

C. hall D. whole

27. The mechanic had to_____under the car to repair it.

A. crawl B. crowul

C. crow D. kraul

Choose the opposite of the underlined words.

28. The customer thought that the cooker was <u>dangerous</u>.

A. risky B. danger

C. unsafe D. safe

29. The wholesaler sold <u>cheap</u> radios.

A. expensive B. new

C. modern D. hard

30. One of the students was still <u>awake</u>.

A. sober B. asleep

C. drunk D. sleeping

Read the following passage and then answer questions 31 to 40.

There was once a king who had only one child, a daughter called Zawadi. She was more beautiful than all the girls in the land. She was so beautiful that her beauty was known even in the neighbouring countries. The king was always pleased wherever people told him how beautiful his daughter was. He knew very well that Zawadi's beauty had come from her mother.

Although Zawadi was very beautiful, she was disliked by people. She was proud and always said that the poor were not good enough for the king's daughter. All her friends, therefore were children of chiefs and the rich. When young men started visiting her asking to marry her, she refused and would laugh at them. Her father became very worried because he knew that one day, Zawadi would leave him and go and start her family. He longed for the day when he could see his grandchild. He tried to advice his daughter to stop being proud, but the princess could hear none of his advice.

31. How many children had the king?
A. Three.
B. One.
C. Two.
D. Four.

32. The word ***"pleased"*** as used in the passage can also be used to mean_____
A. happy
B. sick
C. beautiful
D. wise

33. Give the opposite of the word 'disliked' which has been underlined in the passage
A. hate
B. poor
C. rich
D. liked

34. Zawadi's friends were_____
A. children of chiefs and the rich
B. farmer's children
C. school children
D. teachers children

35. It is **true** to say that Zawadi got her beauty from_____
A. the king
B. her mother
C. her aunt
D. her grandmother

36. Which of the following words can be used to describe Zawadi?
A. Kind.
B. Happy.
C. Proud.
D. Unselfish.

37. Zawadi's beauty was_____
A. known by herself
B. not known by many people
C. known even in the neighbouring countries
D. known only by the young men

38. Write a simile which can describe Zawadi
A. As proud as a peacock
B. As greedy as a hyena
C. As beautiful as Zawadi
D. As fast as a hare

39. What did Zawadi do when young men asked to marry her?
A. Beat them with stones.
B. Sing loudly
C. Clapped her hands
D. Refused and laughed at them

40. The most suitable title for this passage would be
A. Zawadi, the king's daughter.
B. Zawadi the king's wife.
C. The king's son.
D. The king's children.

Read the passage below and then answer questions 41 to 50.

The captain blew the whistle. "Ladies and gentlemen, I would like to request those of you who are travelling to Nairobi to board the train.

The train will leave in ten minutes," he said.

We all boarded and took our seats. Our bags were safely placed in the luggage racks above the seats and the journey began.

For the first time I was afraid of travelling in the long machine. The engine was pulling along twenty -two carriages. As I sat on the train, I wondered who else was travelling with us, and how many people were in the train.

The train's engine was very noisy. After a short while the train picked up speed and it looked as if we were overtaking buses, trailers and even small cars. It moved fast because of its strong engine.

As the train moved away from Kisumu, I could see the Kano plains. I also saw the rice plantations in Ahero. Before long the train reached Nakuru. It stopped for about thirty minutes and then continued with the journey.

We did not fall asleep throughout the journey because we wanted to see the beautiful places we were passing through. We did not even realize that we had reached Nairobi until one of the boys shouted, " we are in the big city!"

At the railway station, the conductor bade us goodbye as we alighted from the train. The journey by train was very enjoyable.

41. When the captain blew the whistle, how much time was left for the train to leave?
A. Ten minutes.
B. 30 minutes
C. 60 minutes
D. $^1/_4$ an hour

42. According to the passage, the luggage racks were
A. below the seats
B. under the seats
C. beside the seats
D. above the seats

43. The train was moving fast because
A. it was long and moving
B. it had a strong engine
C. it looked as if it was overthrown
D. it took less than five hours to get to Nairobi

44. The captain blew the whistle because____
A. some people were standing on the door.
B. he wanted the passengers to board
C. he was the referee
D. the train would speed

45. What is the meaning of the phrase, "***The train picked up the speed***?
A. It started to move very fast
B. It started to move very slowly
C. It became very noisy
D. It started becoming enjoyable

46. The rice plantations were in
A. Nakuru
B. Nairobi
C. Ahero
D. Kisumu

47. Why didn't the writer and his friends fall asleep?
A. The journey was not long
B. The journey was very boring
C. They did not realize they had reached Nairobi
D. They wanted to see the beautiful places

48. Why do you think the train had a strong engine?
A. It produced a lot of noise
B. It moves very fast
C. It was able to overtake buses, trailers and small cars.
D. It was pulling twenty -one carriages

49. People board or alight the train in_____.
A. bus station
B. big towns
C. railway station
D. Kisumu

50. The **best** title for this passage is_____
A. A Journey By a Train
B. A Journey to Nairobi
C. The Kano Plains
D. A Noisy Train

HIGH STRATEGIES EXAM SERIES

TISMAR CODE 03

STD. 5 - END OF TERM 1 - 2020

5

ENGLISH SECTION B: COMPOSITION

Time: 40 minutes

YOUR NAME	
NAME OF YOUR SCHOOL	

Write a composition with the following heading and make it as interesting as possible.

A VISIT TO THE GAME PARK.

HIGH STRATEGIES EXAM SERIES

DARASA LA TANO - MWISHO WA MUHULA WA KWANZA - 2020

KISWAHILI: LUGHA

TISMAR CODE 03

5

Muda: Saa 1 Dak. 40

Chagua neno lifaalo kujazia mianya iliyoachwa wazi kutoka swali la 1 - 15.

Wanyapori ____1____ wanyama wanaoishi ____2____. Nchi ____3____ ina mapori ____4____ yaliyo na wanyama ____5____ sana. Watalii wanapozuru ____6____ yetu au wanapotembelea ____7____ yetu kuja kuwaona wanyama ____8____ porini hulipa ____9____ nyingi sana. Pesa ____10____ husaidia ____11____ kuleta maendeleo ____12____ nchi yetu. Unawajua ____13____ wangapi? Unajua kwamba ____14____ wanyamapori wakubwa na ____15____ wadogo?

1.	A. ni	B. na	C. la	D. ya
2.	A. porini	B. mbugani	C. bustanini	D. msituni
3.	A. yetu	B. letu	C. zetu	D. petu
4.	A. wengi	B. mengi	C. mingi	D. nyingi
5.	A. mengi	B. wengi	C. mingi	D. mingi
6.	A. inchi	B. nchi	C. nchini	D. inchini
7.	A. pahali	B. eneo	C. maeneo	D. mahali
8.	A. lao	B. hawa	C. hao	D. kwao
9.	A. mapeni	B. mahela	C. pesa	D. mapesa
10.	A. hio	B. nayo	C. hizi	D. hizo
11.	A. kuwa	B. kua	C. kwa	D. katika
12.	A. mwa	B. pa	C. la	D. ya
13.	A. wanyamaporini	B. mapori	C. wanyamamaporini	D. wanyamapori
14.	A. kunako	B. kunayo	C. kuna	D. kunazo
15.	A. mengine	B. wengine	C. zingine	D. vingine

Tumia "ingine" kukamilisha sentensi zifuatazo.

16. Sitaki kitabu_____
A. kingine B. zingine
C. vingine D. mengine

17. Gari _____limewasili na wanafunzi
A. lingine B. jingine
C. kingine D. mengine

18. **Kanusha sentensi hii**
Baba atakamua ng'ombe
A. Baba hakamui ng'ombe
B. Baba hajakamua ng'ombe
C. Baba hatakamua ng'ombe
D. Baba asikamue ng;ombe

19. **Kanusha sentensi hii:**
Mwalimu ametufundisha kiswahili
A. Mwalimu hatufundishi kiswahili
B. Mwalimu hatafundisha kiswahili
C. Mwalimu hajatufundisha kiswahili
D. Walimu hawajafundisha kiswahili

Chagua jibu sahihi

20. Watoto _____wamo darasani
A. yote
B. wowote
C. wote
D. zote

21. Sitaki mzaha_____hapa
A. yoyote
B. yeyote
C. zozote
D. wowote

22. **Andika wingi wa**
Kisu kimenolewa leo
A. Visu zimenolewa leo
B. Visu vitanolewa leo
C. Visu vimenolewa leo
D. Visu havijanolewa leo

Tumia 'ingi' kwa usahihi

23. Baada ya kukimbia Jcremia alilowa jasho _____
A. jingi B. mingi
C. mengi D. nyingi

24. Kuna maji _____chunguni.
A. mengi B. nyingi
C. mingi D. jingi

25. Nomino samaki hupatikana katika ngeli gani?
A. KI - VI B. A - WA
C. LI - YA D. U - U

26. **Tegua kitendawili hili**
Nanywa supu, nyama natupa_____
A. firigisi B. papai
C. muwa D. kuku

27. Njunge alimuaga dada yake alamsiki, naye dada yake akamjibu binuru. Ilikuwa wakati gani?
A. Jioni B. Mchana
C. Asubuhi D. Usiku

28. Kiyoyo ni kwa bata naye ndama ni kwa
A. simba B. mbuzi
C. kondoo D. ng'ombe

29. Vazi hili ni



A. gagro B. singeliti
C.kofia D. koti

30. Kati ya vifaa hivi ni kipi hakitumiwi na seremala?

A.

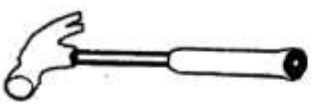

B.

C.



D.

Soma barua hii kisha ujibu maswali 31 mpaka 40.

Shule ya msingi ya koko,
S.L.P 433,
Korokoroni.
3/05/2017.

Kwa mpendwa Baba,

U hali gani? Pokea salamu kutoka kwa mwanao Ema. Natumai u mzima na unachapa kazi vilivyo. Baba,nilipofunga shule muhula wa kwanza, nilifurahi kuwa nambari tatu kati ya watoto tisini na wawili. Nilikuwa na alama mia nne na tano, upinzani ulikuwa mkali mno. Kwani aliyenishinda alikuwa na alama mbili tu mbele yangu.

Watoto wameongezeka sana. Tuko wengi darasani kuliko tulivyokuwemo katika darasa la nne. Somo ambalo lilinitoa jasho ni Kiswahili. Kuliimarisha somo hili naomba uninunulie kitabu cha *kurunzi ya Kiswahili.*

Nakushukuru Baba kwa upendo wako kwangu. Mama na kaka yangu Nyandeke wanaendelea vizuri huku nyumbani.
Kwaheri.

Ndimi Bintiyo
Ema Thiodora

31. Mwandishi anasomea shule gani?
A. Shule ya Msingi ya Koko
B. Shule ya Korokoroni
C. Chuo cha Koko
D. Anwani ya Koko

32. Mwandishi hupata barua yake wapi?
A. Kwenye posta ya Korokoroni
B. Kwenye posta ya Koko
C. Kwenye posta ya Ukwala
D. Kwenye posta ya Kiambu

33. Barua hii iliandikwa lini?
A. 4/3/2017
B. 3/4/2017
C. 3/05/2017
D. 05/3/2017

34. Mpokeaji wa barua hii ni
A. Ema
B. Koko
C. Thiodora
D. Baba

35. Kutokana na barua hii, mwandishi yumo katika darasa la_____
A. nne
B. sita
C. tano
D. saba

36. Aliyemshinda mwandishi alikuwa na alama ngapi?
A. 405
B. 407
C. 402
D. 704

37. Kuna watoto ngapi kwenye darasa la kina mwandishi?
A. 92
B. 62
C. 29
D. 26

38. Ni somo lipi mwandishi hakulifanya vizuri?
A. Kiswahili
B. Hisabati
C. Sayansi
D. Dini

39. Mwandishi anashukuru Babake kwa _____
A. ukarimu wake
B. upendo wake
C. umoja wake
D. kazi yake

40. Ni nani aliyeiandika barua hii?
A. Baba B. Mama
C. Thiodora D. Nyandeke

Soma hadithi hii kisha ujibu maswali 41 mpaka 50.

Tumerudi tena shuleni kwa muhula mwingine. Tuna matumaini kuwa tutasoma salama salimini. Tunawashukuru walimu wetu waliotufundisha mambo mengi. Tulijifunza salamu adabu na heshima. Tuna adabu kwa wakubwa na wadogo. Tunawasalimia wakubwa wote "shikamoo" na tunaheshimiana na vijana wenzetu. Tunatumia lugha za adabu. Tunasema, "ninaomba, tafadhali, samahani, pole na asante."

Tumejifunza vitendawili, hadithi, mashairi nyimbo, methali na mafumbo. Tumeandika na tutaendelea kuandika insha kwa hati nadhifu na imla pia. Tumesoma na tutasoma ngeli pamoja na viashiria, viulizi, vimilikishi vikanushi na vivumishi vyote. Jamani wanafunzi wenzangu tumakinike kwani walimu na wazazi wetu wako tayari kutupiga jeki hivi karibuni katika muhula huu wa pili. Wote wanataka tufaulu masomoni kisha maishani.

41. Kauli **"Tumerudi tena"** inamaanisha kuwa
A. wanafunzi walikuwa likizoni
B. wanafunzi walienda matembezi
C. wanafunzi walienda harusini
D. wanafunzi walienda michezoni

42. Wanafunzi watasomaje muhula huu?
A. Salama sana
B. Salama salimini
C. Salimini tu
D. Kwa huzuni

43. Walimu wamepewa shukrani kwa sababu gani?
A. Hawakuwafundisha mambo mengi
B. Walijaribu kuwafundisha
C. Waliwafundisha mambo mengi
D. Walitamani kuwafundisha

44. Watoto walijifundisha mambo haya yote shuleni isipokuwa
A. salamu na adabu
B. vitendawili na hadithi
C. ukulima na uchimbaji
D. methali na mafumbo

45. Salamu ya wadogo kwa wakubwa ni gani anavyosema mwandishi?
A. Mambo
B. Ni aje
C. Sasa buda
D. Shikamoo

46. Mwandishi anawahimiza wanafunzi wenzake wafanye nini?
A. wasisome hadithi
B. wasiwe na adabu
C. wamakinike kimasomo
D. wawe watoro shuleni

47. Ni ipi siyo lugha ya adabu asemavyo mwandishi
A. tafadhali
B. samahani
C. asante
D. nataka

48. Jibu la salamu ***shikamoo*** ni
A. marahaba
B. shikamoo sana
C. asante sana
D. karibu

49. Wanafunzi waliandikaje insha?
A. Kwa udhaifu
B. Kwa unyonge
C. kwa hati nadhifu
D. kwa uvivu

50. Hadithi hii inaweza kuelezwa wapi?
A. Nyumbani.
B. Hospitalini.
C. Shambani.
D. Shuleni.

HIGH STRATEGIES EXAM SERIES

MWISHO WA MUHULA WA KWANZA - 2020

TISMAR CODE 03

KISWAHILI SEHEMU YA PILI : INSHA

5

DARASA LA TANO

SEHEMU YA PILI: INSHA *Muda: Dakika 40*

JINA LAKO	
JINA LA SHULE	

Andika insha ya kupendeza juu ya kichwa:

KAUNTI YETU.

HIGH STRATEGIES EXAM SERIES

TISMAR CODE 03

STD. 5 - END OF TERM 1 - YEAR 2020

MATHEMATICS

5

Time: 2hrs

1. Write six hundred and ninety thousand and eighty four in symbols

A. 690 080 B. 690 084
C. 69084 D. 690840

2. What is the place value of digit 6 in the number 618427?

A. Ones
B. Ten thousands
C. Thousands
D. Hundred thousands

3. Round off 8135 to the nearest tens

A. 8140 B. 8200
C. 8130 D. 8136

4. What is the next number in the sequence below?

3, 9, 15, 21_____

A. 28 B. 30
C. 22 D. 27

5. Which of the following numbers is a prime number?

A. 81 B. 64
C. 51 D. 79

6. Simplify the fraction $^{84}/_{100}$ by cancelling

A. $^{42}/_{50}$ B. $^{21}/_{25}$
C. $^{1}/_{2}$ D. $^{3}/_{10}$

7. Find the perimeter of the figure shown below

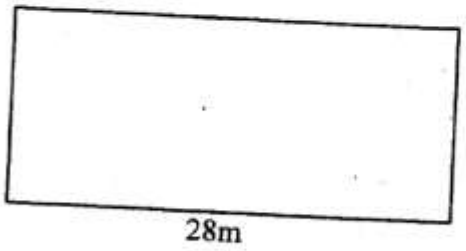

A. 41m B. 82m
C. 62m D. 80m

8. Find the GCD of 16, 20 and 28

A. 28 B. 64
C. 560 D. 4

9. What is the total value of digit 2 in the number 279864?

A. 20000
B. 200000
C. 2000
D. Hundred thousands

10. Which of the fractions given below has the greatest value?

A. $^{3}/_{5}$ B. $^{6}/_{11}$
C. $^{4}/_{8}$ D. $^{3}/_{4}$

11. Which of the following numbers is divisible by 9?

A. 1108 B. 992
C. 7641 D. 11396

12. Find LCM of 24, 30 and 36

A. 360 B. 108

C. 180 D. 120

13. Convert $^{5}/_{8}$ into a decimal

A. 5.8 B. 0.65

C. 0.625 D. 0.54

14. Round off 963218 to the nearest hundreds

A. 960000 B. 963000

C. 963200 D. 963300

15. What is the place value of digit 7 in the number 4.167?

A. Ones B. Hundredths

C. Thousandths D. Tenths

16. How many $^{1}/_{2}$litre cups be used to fill a 50 litre can?

A. 25 B. 48

C. 200 D. 100

17. How many small cubes make the stack shown below?

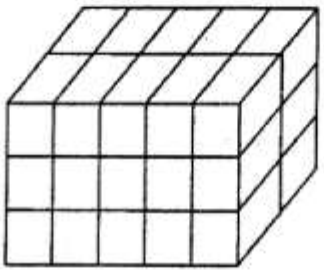

A. 30 B. 60

C. 48 D. 24

18. **Work out**

$^{8}/_{9} + {}^{3}/_{5} =$

A. $^{11}/_{14}$ B. $^{67}/_{45}$

C. $1^{22}/_{45}$ D. $1^{11}/_{45}$

19. Write 18 in roman numerals

A. XL B. LVIII

C. XVIII D. XIV

20. **Work out**

18.13 - 9.47=

A. 9.66 B. 8.66

C. 9.76 D. 8.76

21. Which of the following is the prime factorization of 36

A. 2x2x3 B. 2x2x9

C. 2x2x3x3 D. 2x2x2x3

22. Name the point of intersection

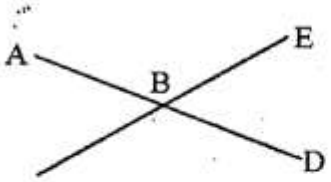

A. E B. C

C. D D. B

23. Which of the following angles is obtuse?

A. 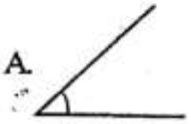

B. 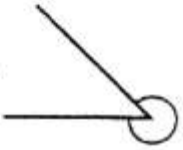

C.

D.

24. **Work out**

$18^{3}/_{4} - 8 =$

A. $10^{27}/_{40}$ B. $10^{3}/_{4}$

C. $10^{1}/_{4}$ D. $9^{3}/_{4}$

25. Twelve men shared sh 6048 equally. How much did each man get?

A. sh 540 B. sh 54
C. sh 504 D. sh 5040

26. Convert 84 months into years

A. 7 years B. 8 years
C. 6 years D. 4 years

27. What is a seventh of 63?

A. 9 B. 6
C. 8 D. 12

28. **Work out**

$3^{2}/_{3} + 1^{4}/_{5} =$

A. $4^{6}/_{8}$ B. $4^{3}/_{4}$
C. $5^{7}/_{15}$ D. $4^{7}/_{15}$

29. What is the time shown by the clock face below?

A. 12 o'clock B. 3 o'clock
C. quarter past 12 D. quarter past 3

30. Joshua bought the following items from a shop;

An exercise book for sh 27
a pen sh 35
a rubber for sh 7.

He gave the shopkeeper a sh 100 note. How much balance did he receive?

A. sh 69 B. sh 31
C. sh 64 D. sh 70

31. There are 184325 males and 276998 females in a county. How many people are in the county altogether?

A. 461323 B. 361323
C. 460323 D. 460423

32. Which of the following digits in the number 209.48 is in the hundredths place value?

A. 9 B. 4
C. 8 D. 0

33. What fraction of the figure below is unshaded

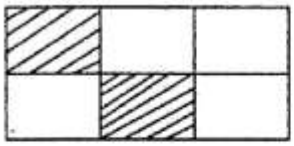

A. $^{2}/_{6}$ B. $^{2}/_{3}$

C. $^{1}/_{6}$ D. $^{2}/_{4}$

34. How many days were there in the months of June, July and August 2010?

A. 90
B. 91
C. 89
D. 92

35. **Work out**

m	cm
10	30
-7	40

A. 3m 10cm
B. 3m 90cm
C. 2m 90cm
D. 2m 10cm

36. How many quarter kgs are there in 36 kilograms?
A. 9 B. 40
C. 144 D. 124

37. **Work out**
$8^{1}/_{3} \times 42 =$
A. 350 B. 284
C. 336 D. 346

38. Change 0.8 into a simplified fraction
A. $^{8}/_{10}$ B. $^{1}/_{2}$
C. $^{2}/_{3}$ D. $^{4}/_{5}$

39. Angie has x cows and y sheep. Find the total number of animals she has
A. xy B. y-x
C. x-y D. x+y

40. Write $17^{3}/_{4}$ as an improper fraction
A. $^{68}/_{4}$ B. $^{173}/_{4}$
C. $^{73}/_{4}$ D. $^{71}/_{4}$

41. A farmer harvested 4928kg of maize. He packed the maize into 16kg packets. How many packets did he pack?
A. 380 B. 3080
C. 3008 D. 308

42. Write $^{2}/_{5}$ as a decimal
A. 0.25 B. 2.5
C. 0.4 D. 0.04

43. Change 6 hours 35 minutes into minutes
A. 360 min B. 405 min
C. 635 min D. 395 min

44. Which of the following numbers is divisible by both 3 and 4
A. 82
B. 60
C. 123
D. 150

45.
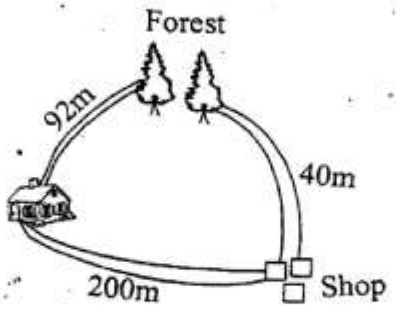

Kibe walked from the shop to his home through the forest. What distance did he cover?
A. 132m B. 200m
C. 140m D. 240m

46. **Subtract**
98000 from 926400
A. 828400 B. 828040
C. 828004 D. 808400

47. What is the next multiple of 6 after 132?
A. 136 B. 140
C. 148 D. 138

48. Today is Thursday 2nd March. Which day will it be on 19th March
A. Saturday B. Monday
C. Thursday D. Sunday

The table below shows tallies for the number of balls.

Colour of ball	Number	Tallies
Red	12	𝍸 𝍸 ||
Green	——	𝍸 |||
White	6	——

49. How many balls are there altogether?
A. 20 B. 18
C. 23 D. 26

50. Which tallies represent white balls?
A. \|\|\|\| B. 𝍸
C. 𝍸 \| D. 𝍸 𝍸

HIGH STRATEGIES EXAM SERIES

STD. 5 - END OF TERM 1 - YEAR 2020

TISMAR CODE 03

5

SCIENCE

Time : 1 Hour 40 Mins

1. Which of the following types of teeth is used in biting and cutting food in human biengs?

A.

B.

C.

D.

2. Which stage of HIV infection is the last one?
   A. Window.
   B. Full blown.
   C. Incubation.
   D. Symptomatic.

3. Body building foods are also called
   A. proteins
   B. carbohydrates
   C. vitamins
   D. meat

4. Poultry kept for eggs are called
   A. broilers B. hens
   C. chicken D. layers

5. Crops which produce threads are referred to as
   A. oil crops
   B. beverages
   C. legumes
   D. fibre crops

6. Which of the following is **not** a function of leaves in a plant?
   A. Gaseous exchange.
   B. Photosynthesis.
   C. Transpiration.
   D. Absorption of water.

Use the digestive system drawn below to answer questions 7 to 10.

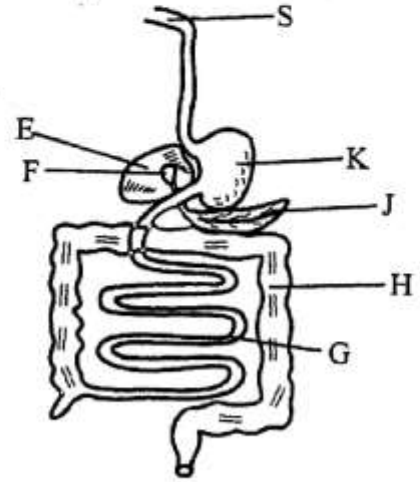

7. Name the parts marked E and J respectively
   A. Bile, pancrease
   B. Stomach, pancrease
   C. Liver, gall bladder
   D. Liver, pancrease

8. What is the function of the part marked H?
   A. Absorbs water and minerals salts
   B. Produces digestive juices
   C. Completes digestion
   D. Absorbs digested food

9. Digestion of food ends in the part marked
   A. K B. H
   C. E D. G

10. Name the digestive juice produced in the part marked **S**
    A. pancreatic B. bile
    C. gastric D. saliva

11. The following are characteristics of Nimbus clouds **except**
    A. look like small cotton balls
    B. are grey in colour
    C. look like mountains
    D. are a sign of heavy rains

12. The initials AIDS stands for_____
A. Acquired Immune Deficiency Syndrome
B. Acquired Immune Disease Syndrome
C. Acquired Immune Death Syndrome
D. Acquired Immune Disease Syndrome

13. Which of the following is **not** a proper storage of medicine?
A. Labelling well before storage.
B. Storing medicine in soda bottles.
C. Storing medicine in lockable cupboards.
D. Storing medicine in clean and dry places.

14. HIV/AIDS is spread through all the following ways **except**
A. sexual intercourse with an infected person
B. infected mother to her child during birth
C. sharing of skin piercing and cutting objects
D. swimming together with an infected person

15. Name the type of root system shown below

A. fibrous
B. tap
C. prop
D. main

16. Which of the following is **not** a reason why we use medicines?
A. To treat diseases
B. To increase weight
C. To prevent diseases
D. To relieve pain

17. Chemicals used for killing ticks are called
A. acaricides
B. herbicides
C. pestcides
D. tickcides

18. Which tool among the following is used in cutting wood?

A.

B.

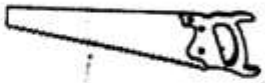

C.

D.

19. For a plant to make its own food,all the following are necessary **except**
A. chlorophyll
B. water
C. sunlight
D. soil

20. A metal can be made to float on water by changing its
A. size
B. length
C. shape
D. material

21. The experiment below was carried out by std 5 pupils.

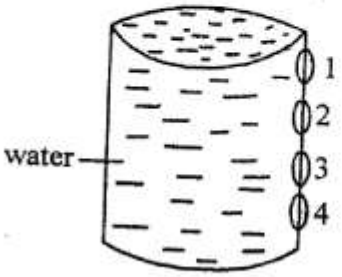

On which hole in the can above can a tap be placed?
A. 1
B. 2
C. 3
D. 4

22. In the above experiment pupils concluded that pressure in liquids
A. increases with depth
B. decreases with depth
C. increases with height
D. decreases with volume

23. The following are functions of the roots. Which one is **not**?
A. Absorption of water.
B. Support the plant.
C. Store food in some plants.
D. Transport water.

24. Name the weather instrument shown below

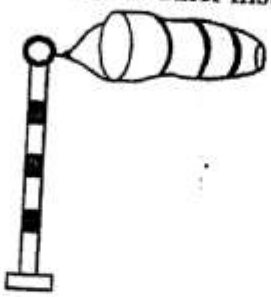

A. windsock
B. windvane
C. thermometer
D. raingauge

25. The above weather instrument is used in showing the
A. speed of wind
B. temperature of wind
C. amount of rainfall
D. direction and strength of wind

26. Which of the following is **not** a special sound?
A. Hooting from a car.
B. Ambulance siren.
C. Reading loudly.
D. A bell ringing.

27. Which of the following uses of water can be used in both the industry and in the farm?
A. Irrigation.
B. Bathing.
C. Watering animals.
D. Mixing chemicals.

28. Which one of the following is a cereal?
A. Yam.
B. Beans.
C. Carrot.
D. Maize.

29. Which of the following is not a protective behaviour in animals?
A. Stinging.
B. Coiling.
C. Biting.
D. Crawling.

30. Which of the following activities does **not** need heat?
A. Taking photographs.
B. Drying clothes.
C. Cooking food.
D. Ironing clothes.

Use the diagram below to answer questions 31 to 33.

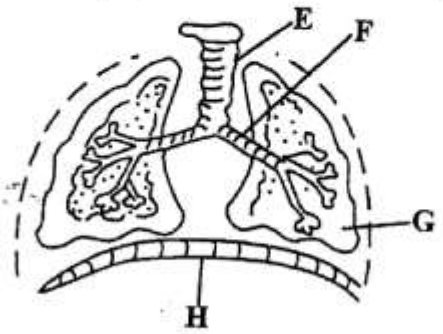

31. Which of the marked parts is the trachea?
A. E
B. F
C. G
D. H

32. The part marked **G** _____ during breathing in
A. expands
B. shrinks
C. contracts
D. flattens

33. Name the part marked H
A. Diaphragm
B. Ribs
C. Bronchus
D. Lungs

34. Which one of the following is **not** a type of weed?
A. Blackjack.
B. Wandering jew.
C. Oxalis.
D. Spinach.

35. The date before which medicine should be used is known as
A. expiry date
B. manufacturing date
C. delivery date
D. supply date

36. The ability of the body to fight against diseases is called
A. syndrome
B. immunity
C. deficiency
D. syndrome

37. Which of the following is **not** a good behaviour when having meals?
A. Talking with food in mouth.
B. Chewing food with the mouth closed.
C. Chewing food properly.
D. Eating reasonable quantities of food at a time.

38. The following are problems related to teeth **except**
A. bad smell
B. bleeding gums
C. tooth decay
D. shedding teeth

39. Gestures are commonly used in_____
A. transport
B. communication
C. feeding
D. seeing

40. Why are vaccines taken?
A. To prevent diseases.
B. To cure diseases.
C. To treat diseases.
D. To reduce pain.

41. Which is the best method of controlling weeds in a large farm?
A. Digging out.
B. Slashing.
C. Use of chemicals.
D. Uprooting.

Study the weather chart below to answer questions 42 to 44

	MORNING	AFTERNOON
MONDAY		
TUESDAY		
WEDNESDAY		
THURSDAY		

42. How was the weather on Tuesday morning?
A. Calm.
B. Windy.
C. Cloudy.
D. Rainy.

43. Which day did people use umbrellas throughout?
A. Monday
B. Tuesday
C. Wednesday
D. Thursday

44. Which was the **best** day to wash clothes?
A. Monday
B. Tuesday
C. Wednesday
D. Thursday

45. Which of the following small animals lives in the soil?
A. Millipede.
B. Housefly.
C. Wasp.
D. Lizard.

46. Which of the following are products of a goat?
A. Wool and mutton.
B. Beef and milk.
C. Dairy and mutton.
D. Dairy and pork.

47. The following are natural ways of lighting a house **except**
A. translucent roofs
B. opening windows
C. opening doors
D. using candles

48. Which one of the following is a protective food?
A. Bean.
B. Ripe banana.
C. Yoghurt.
D. Green banana.

49. Which animal among the following is an invertebrate?
A.
B.
C.
D.

50. Digestion of arrow roots starts in the
A. mouth
B. stomach
C. ileum
D. duodenum

HIGH STRATEGIES EXAM SERIES

TISMAR CODE 03

STD. 5 - END OF TERM 1 - 2020

5

SOCIAL STUDIES

Time: 2hrs 15min

KWENGU AREA

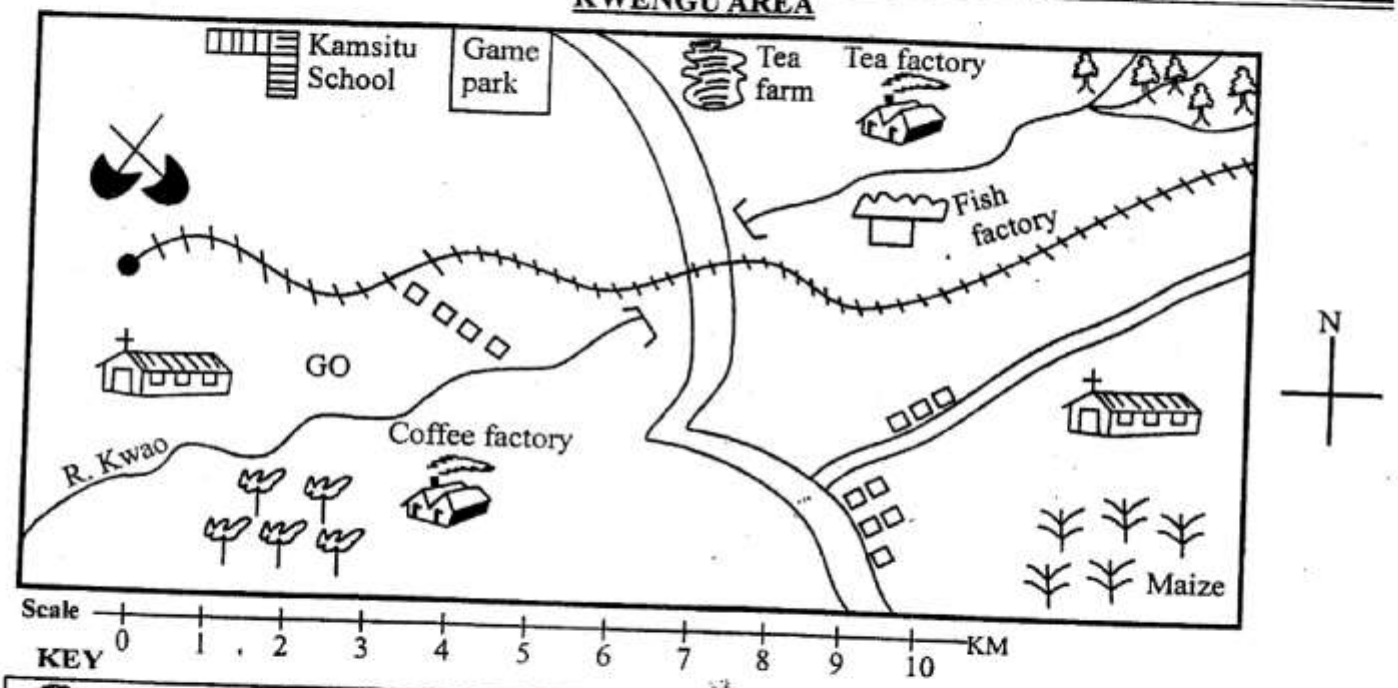

KEY

factory	Maize farms	GQ - Governor's Office	Church
Quarry	Tarmac road	Railway	Forest / Coffee

Study the map of Kwengu Area shown above and then answer questions 1 to 7.

1. People of Kwengu Area are_____
   A. Pagan B. Hindu
   C. Christians D. Muslims
2. Kwengu Area is administered by a
   A. D.C B. P.C C. Chief D. Governors
3. What is the direction of the quarry from the coffee factory?
   A. South East B. North West
   C. West D. East West
4. Name the cash crops grown in Kwengu Area
   A. maize and beans B. wheat and maize
   C. cocoa and nice D. coffee and tea
5. River Kwao flows from_____to direction
   A. North East to South West
   B. North West to South East
   C. South to North
   D. South West to North East
6. Which economic activity is **not** carried out in kwengu Area?
   A. Mining B. Tourism
   C. Farming D. Lumbering
7. Which is the most common means of transport in Kwengu Area?
   A. Railway B. Air
   C. Road D. Water
8. Money needed by a person to start a business is known as
   A. notes B. cash
   C. money D. capital
9. Cutting down of trees without replacing them is known as
   A. afforestation B. deforestation
   C. agro forestry D. lumbering
10. Nagana disease is spread by
    A. mosquito B. tsetse fly
    C. fly D. ticks
11. A good map should have all the following **except**
    A. title B. scale
    C. frame D. colour

Use the diagram below to answer questions that follow.

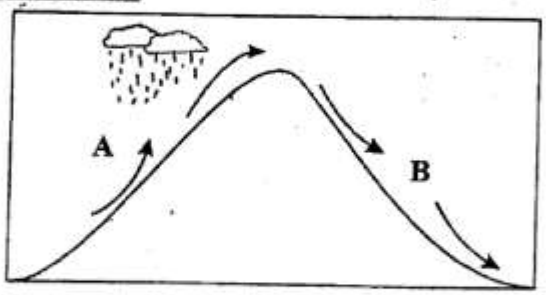

12. The type of rainfall illustrated above is called
A. convectional B. frontal
C. cyclonic D. relief
13. The side marked A is called
A. dry land B. windward
C. rainshadow D. rainland
14. Which town is likely to be found in the side marked **B**?
A. Meru. B. Nanyuki. C. Nakuru. D. Nyeri.
15. The main commercial crop grown at Mwea irrigation scheme is
A. sisal B. onions C. rice D. cotton
16. _____is planting of forests on hilly areas and steep river valleys where there was none.
A. Deforestation B. Re-afforestation
C. Conservation D. Afforestation
17. Which one of the following is **not** an element of weather?
A. Longitudes B. Rainfall
C. Temperature D. Wind
18. In the olden day, disputes were settled by the
A. missionaries B. council of elders
C. pastors D. women
19. Which of the following lakes is **not** found on the floor of the Rift valley?
A. Lake Nakuru. B. Lake Victoria.
C. Lake Turkana. D. Lake Naivasha.
20. Where is flourspar mined in Kenya?
A. Kariandusi. B. Lake. Magadi
C. Kerio valley D. Athi river
21. The four **main** points of a compass are called
A. points B. cardinal points
C. N.E.S.W D. main points
22. The compass direction between South and East is
A. S.E.S B. South East
C. W.S.W D. South West
23. Which of the following is **not** a condition necessary for the growth of tea?
A. Dry season during harvesting
B. Cool and wet climate
C. High altitude
D. High rainfall
24. Which of the following is a non-verbal means of traditional communication?
A. Screams. B. Sending a messenger
C. Drum beating D. Smoke
25. The arrow of wind -vane points
A. where the wind is blowing to
B. where wind is blowing from
C. direction of the wind
D. speed of wind
26. The second president of Kenya became the president in the year
A. 1963 B. 1992 C. 1978 D. 1998
27. Which is the headquarters of Nairobi County?
A. Nakuru B. Nairobi C. Garissa D. Mandera
28. If you were driving along a busy road and you saw the sign below, what should you do?

A. stop B. slow down
C. increase speed D. know there is a barrier
29. Lack of rain is called
A. famine B. drought C. floods D. irrigation
30. Which of the following is not a tourist attraction in Kenya?
A. African culture. B. Cities.
C. Beaches. D. Climate.
31. Dairy cattle are kept for _____
A. milk B. meat C. eggs D. hide and seek
32. Rivers flow from _____places.
A. high to low B. low to high
C. flat to high D. highlands to hills
33. Which of the following is not traditional industry?
A. Leather work B. Vehicle assembly
C. Pottery D. Iron working
34. This weather instrument is known as a

A. raingauge B. anemometer
C. windvane D. windsock
35. The main vegetation found in the Nyika plateau is
A. acacia and baobab
B. pine and cypress
C. cactus and mahogany
D. meru oak and baobab

Use the map to answer questions 36 to 39.

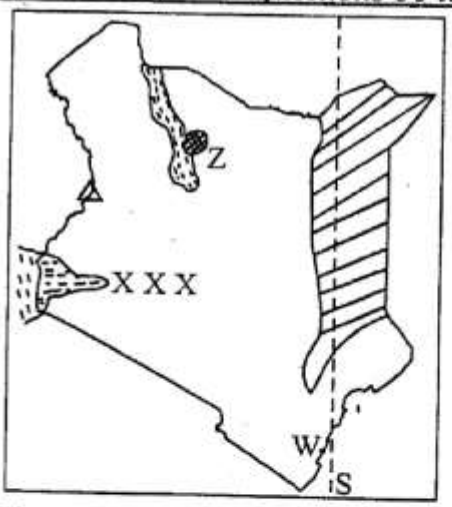

36. The region marked **xx** experiences____type of rainfall.
A. relief B. frontal
C. convectional D. cyclonic

37. The town marked **W** is
A. Mombasa B. Lamu
C. Kipini D. Malindi

38. The mountain shown is Mt_____
A. Elgon B. Kenya
C. Kilimanjaro D. Marsabit

39. The main tourist attraction in the national park marked **Z** is
A. snakes B. pyramids
C. wild animals D. beaches

40. Which one of the following is **not** a reason for migration?
A. War
B. Search for new breeds of animals
C. Outbreak of diseases
D. Search for fertile lands

41. Most Kenyans are citizen by
A. birth B. naturalisation
C. registration D. migration

42. Among the following, which one is **not** a beef cattle?
A. Charolis B. Hereford
C. Jersey D. Aberdeen Angus

43. In the olden days, people worshipped in
A. dens B. churches C. shrines D. mosques

44. An age-group is made of
A. people who married together
B. many age sets
C. people who are nearly the same age
D. members of the same family

45. Which community among the following is a Bantu?
A. Pokomo B. Samburu
C. Somali D. Maasai

46. The **main** economic activity around Lake Magadi is
A. Mining B. Fishing
C. Pastoralism D. Farming

47. The source of River Athi is at
A. Mount Kenya B. River Tana
C. Ngong hills D. Mau ranges

48. Among the following, who is not a member of the nuclear family?
A. Father B. Daughter
C. Mother D. Son in-law

49. Which method of communication is the odd one out?
A.
B.
C.
D. 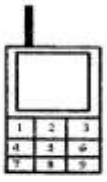

50. Which one of the following is **not** a use of water?
A. Used as a mineral
B. Transport
C. Production of hydro electric power
D. Irrigation

51. The short rains in Kenya usually falls in the months of_____and _____
A. April and June
B. October and November
C. July and August
D. January and March

52. Kenya has _____elected governnors.
A. 47 B. 48 C. 290 D. 280

53. Moving air helps in_____
A. blowing off roots
B. moving wind mills
C. moving vehicles
D. growing crops

54. Which one of the following is **not** a hardwood tree?
A. Camphor. B. Oak.
C. Pine. D. Teak.

55. On 1st June every year Kenyans celebrate
A. Jamhuri day B. Madaraka day
C. Independent day D. Kenyatta day

56. If a thief is caught in a village, the nearest person to report to is the
A. assistant chief B. police
C. chief D. teacher

57. _____is a modern form of transport in Kenya.
A. Donkey B. Oxen
C. Camel D. Air

58. The quickest means of communication today is
A. radio B. newspaper
C. drum D. mobile phone

59. Elections in Kenya are held after _____ years.
A. 4 B. 5 C. 6 D. 8

60. Who was the first president of Kenya?
A. Kijana Wamalwa B. Jomo Kenyatta
C. Oginga Odinga D. Mwai Kibaki

SECTION B
CHRISTIAN RELIGIOUS EDUCATION

61. Human beings were created in the image of
A. Adam B. Angels C. God D. Eve

62. _____was the father of Isaac
A. Noah B. Abraham
C. Moses D. Solomon

63. Noah and his family were saved by God from the
A. lightening B. fire
C. hunger D. floods

64. The story of creation is found in the book of
A. Exodus B. Job
C. Kings D. Genesis

65. Moses saw_____as a presence of God
A. burning bush B. flowing river
C. flying dove D. angels

66. _____was the wisest king of Israel.
A. Solomon B. Samson
C. David D. Gideon

67. Jeremiah was chosen by God before he was_____
A. baptised B. killed
C. born D. stoned

68. Joshua led the Israelites into the promised land called
A. Canaan B. Israel
C. Egypt D. Jericho

69. Joseph stayed in the temple under the care of priest
A. Eli B. Jethro
C. Jacob D. Elkanah

70. How many commandments were given to the Israelites?
A. 5 B. 12 C. 10 D. 20

71. When Jesus walked on water. He showed that he had power over
A. water B. disciples
C. nature D. God

72. Jesus is also known as the prince of
A. hatred B. sinners
C. peace D. greed

73. Who betrayed Jesus?
A. Simon. B. Thomas.
C. Peter. D. Judas Iscariot.

74. The followers of Jesus were first called Christians at the town of
A. Jerusalem B. Antioch
C. Bethany D. Bethlehem

75. Which is the main way in which Christians communicate to God? Through
A. Prayers. B. Baptism.
C. Gestures D. Communion

76. When we are wronged by others we should _____them.
A. forgive B. beat
C. curse D. abuse

77. According to St James faith without action is
A. cheap B. satanic
C. dead D. alive

78. Our bodies are the temples of the_____
A. men B. women
C. church D. holy spirit

79. I am fearfully and _____made
A. carelessly B. shapeless
C. cheaply D. wonderfully

80. The different roles performed by boys and girls are called_____roles
A. gender B. class
C. age D. peer

81. Why should we observe the Sabbath day?
A. To rest
B. It is a command from God
C. To make money
D. To visit friends

82. A good leader must have all the following qualities **except**
A. humility B. honesty
C. patience D. pride

83. For how long does the unborn baby stay in the mothers womb?
A. 9 months B. 9 years
C. 9 days D. 1 month

84. Happy are those who_____for God will comfort them
A. mourn B. cry
C. bury D. die

85. Which was the first miracle of Jesus to perform?
A. Raising lazarus from death
B. Feeding the 5000 people
C. Calming the storm
D. Changing water into wine

86. The following are the fruits of the Holy Spirit **except**
A. peace B. joy
C. wisdom D. self control

87. It is God's command for us to_____those in authority
A. disobey B. respect
C. hate D. abuse

88. The apostles creed says that Jesus was conceived by the power of_____
A. Mary
B. Joseph
C. Wisemen
D. Holy Spirit

89. Which of the following is an effect of irresponsible boy/girl relationship?
A. Good results in school.
B. More knowledge about God
C. Teenage pregnancies
D. Successful marriage.

90. Which one of the following is **not** a good quality of a friend?
A. Kindness
B. Selfishness
C. Faithfulness
D. Honesty